RAISING TINY FEET

NAME:

DATE:

Which of the things below are the longest in each group?

1



2



3

1



2



1

2